Symmetry · Grade K

Read each question carefully. They're not all the same kind of question.

Name _____ Date _____ Score _____ / 4

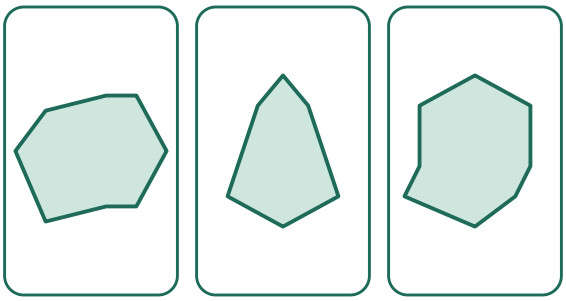

01 Circle the shape that has a line of symmetry. _____

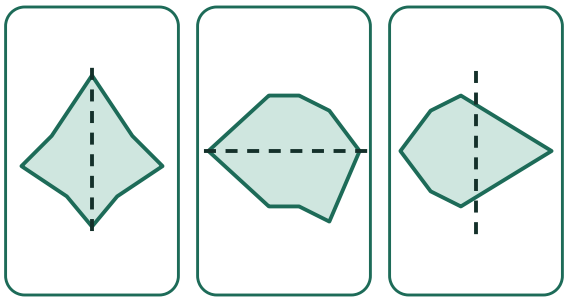

02 Circle the picture where the line makes two matching halves. _____

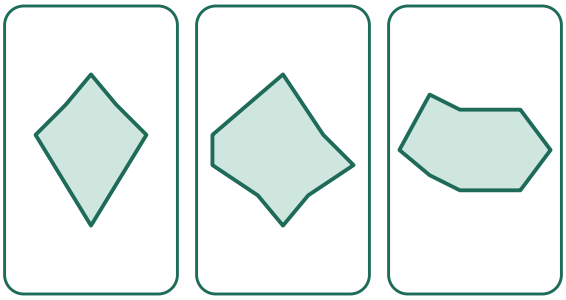

03 Circle the shape that has a line of symmetry. _____

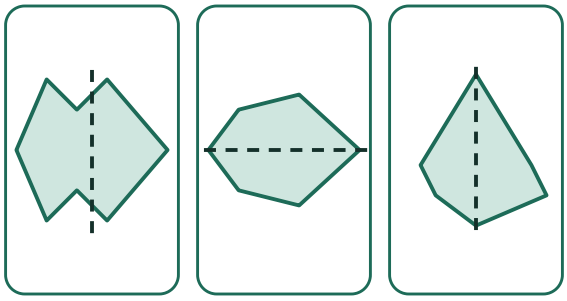

04 Circle the picture where the line makes two matching halves. _____

Symmetry · Grade K (Answer Key)

Read each question carefully. They're not all the same kind of question.

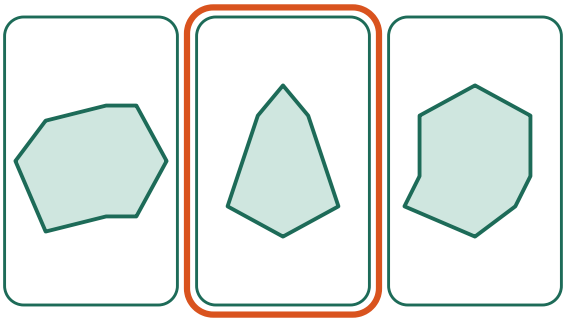

01 Circle the shape that has a line of symmetry. **Middle**

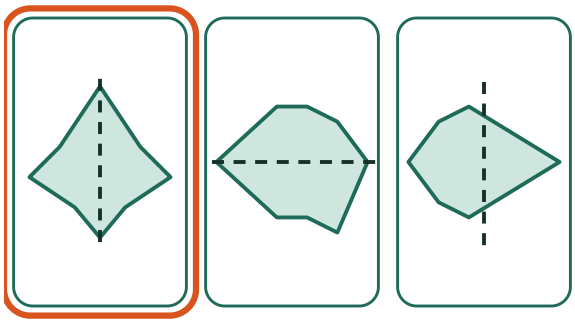

02 Circle the picture where the line makes two matching halves. **Left**

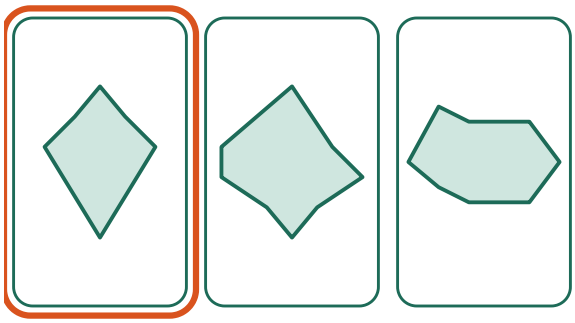

03 Circle the shape that has a line of symmetry. **Left**

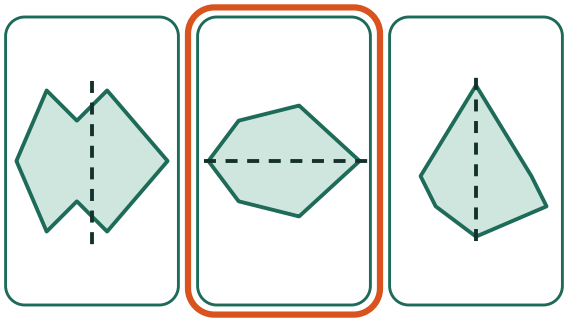

04 Circle the picture where the line makes two matching halves. **Middle**