Symmetry · Grade K

Read each question carefully. They're not all the same kind of question.

Name _____ Date _____ Score _____ / 4

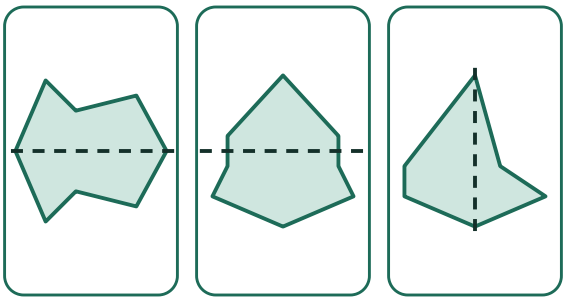

01 Circle the picture where the line makes two matching halves. ____

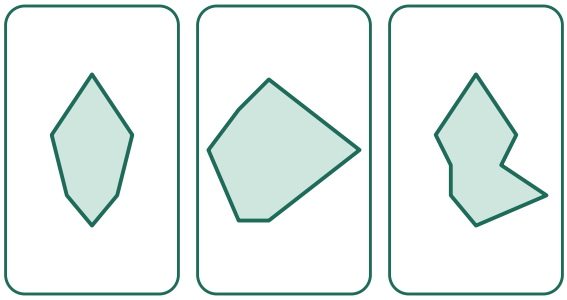

02 Circle the shape that has a line of symmetry. ____

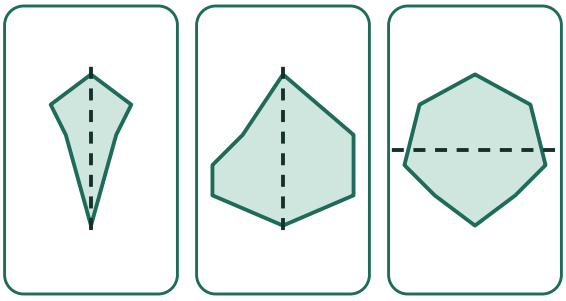

03 Circle the picture where the line makes two matching halves. ____

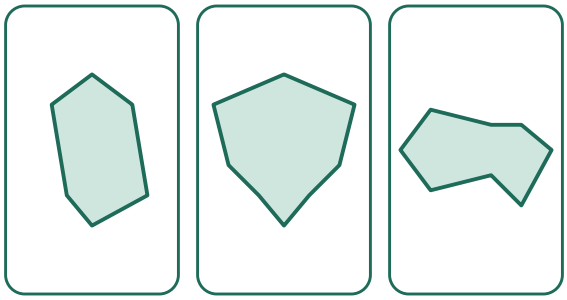

04 Circle the shape that has a line of symmetry. ____

Symmetry · Grade K (Answer Key)

Read each question carefully. They're not all the same kind of question.

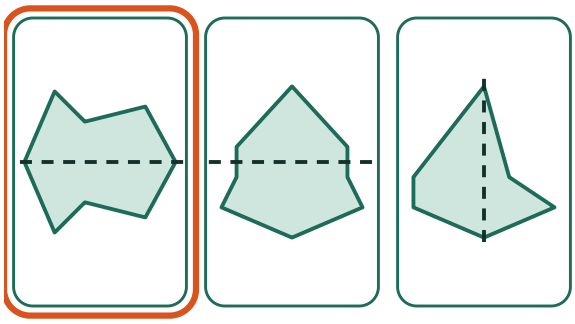

01 Circle the picture where the line makes two matching halves. **Left**

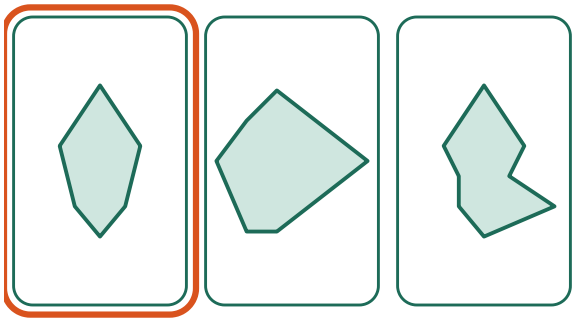

02 Circle the shape that has a line of symmetry. **Left**

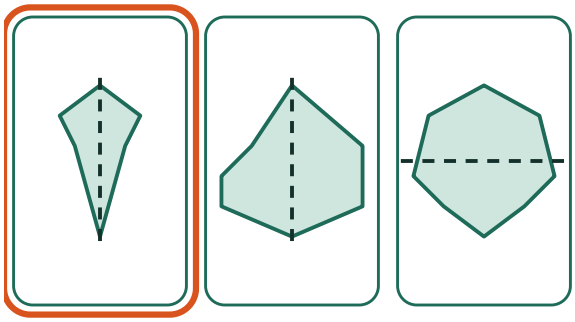

03 Circle the picture where the line makes two matching halves. **Left**

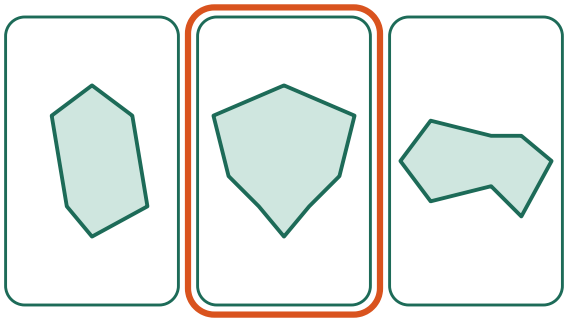

04 Circle the shape that has a line of symmetry. **Middle**