Nets of 3D Shapes · Grade 7

Look at each net, then answer the question.

Name _____ Date _____ Score _____ / 4

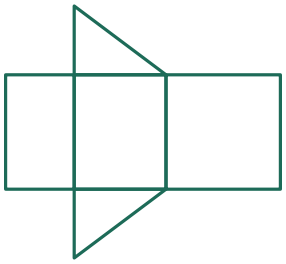

01 Which solid does this net fold into?

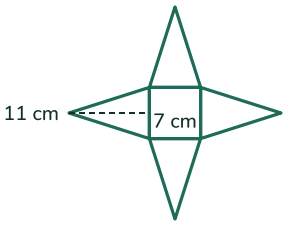

02 What is the surface area of the square pyramid this net makes?

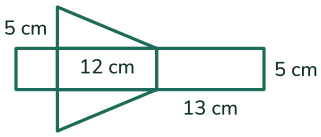

03 What is the surface area of the triangular prism this net makes?

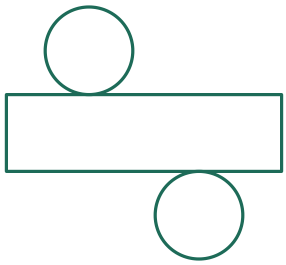

04 Name the solid this net makes.

Nets of 3D Shapes · Grade 7 (Answer Key)

Look at each net, then answer the question.

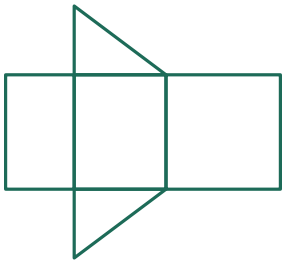

01 Which solid does this net fold into?

triangular prism

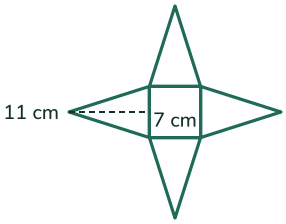

02 What is the surface area of the square pyramid this net makes?

203 cm²

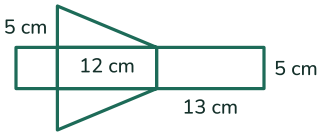

03 What is the surface area of the triangular prism this net makes?

210 cm²

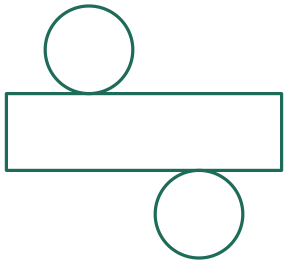

04 Name the solid this net makes.

cylinder