Nets of 3D Shapes · Grade 7

Look at each net, then answer the question.

Name _____ Date _____ Score _____ / 4

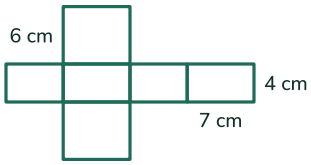

01 What is the surface area of the rectangular prism this net makes?

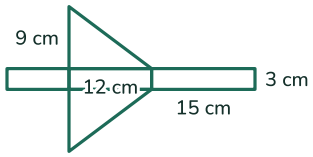

02 What is the surface area of the triangular prism this net makes?

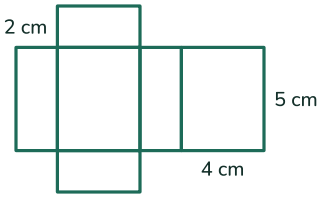

03 What is the surface area of the rectangular prism this net makes?

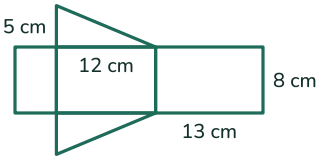

04 What is the surface area of the triangular prism this net makes?

Nets of 3D Shapes · Grade 7 (Answer Key)

Look at each net, then answer the question.

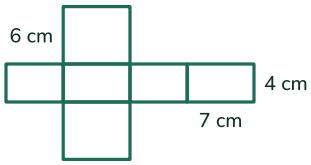

01 What is the surface area of the rectangular prism this net makes? **188 cm²**

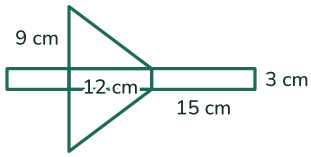

02 What is the surface area of the triangular prism this net makes? **216 cm²**

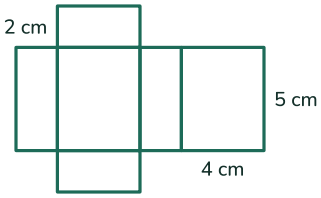

03 What is the surface area of the rectangular prism this net makes? **76 cm²**

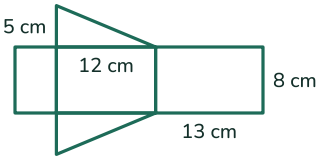

04 What is the surface area of the triangular prism this net makes? **300 cm²**