Data & Graphs · Grade 7

Name _____ Date _____ Score _____ / 6

01 Use the circle graph about favourite subject.

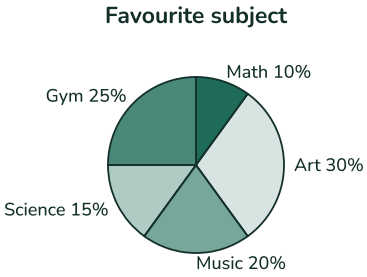

Source: class survey

a) What percent of the students chose math?

b) What percent of the students chose gym?

c) What percent of the students are in the “Science” and “Gym” sectors together?

02 Use the circle graph about how students get to school.

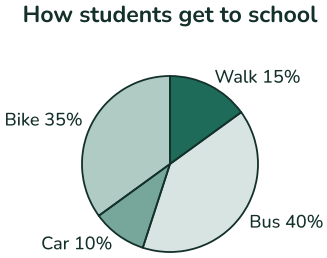

Source: morning count

a) What percent of the students come by car?

b) What percent of the students take the bus?

c) What percent of the students are in the “Bus” and “Car” sectors together?

Data & Graphs · Grade 7 (Answer Key)

01 Use the circle graph about favourite subject.

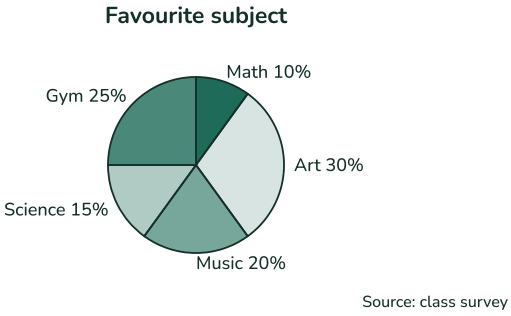

Source: class survey

a) What percent of the students chose math? **10%**

b) What percent of the students chose gym? **25%**

c) What percent of the students are in the “Science” and “Gym” sectors together? **40%**

02 Use the circle graph about how students get to school.

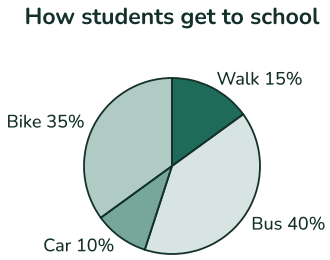

Source: morning count

a) What percent of the students come by car? **10%**

b) What percent of the students take the bus? **40%**

c) What percent of the students are in the “Bus” and “Car” sectors together? **50%**