Nets of 3D Shapes · Grade 6

Look at each net, then answer the question.

Name _____ Date _____ Score _____ / 4

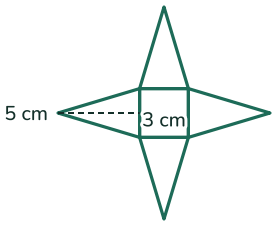

01 What is the surface area of the square pyramid this net makes?

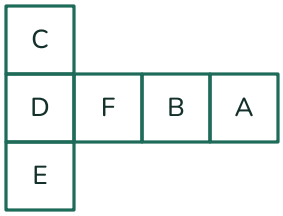

02 Fold this net into a cube. Which letter is opposite face E?

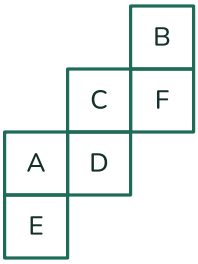

03 Fold this net into a cube. Which letter is opposite face C?

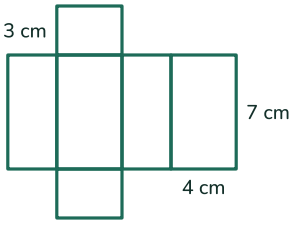

04 What is the surface area of the rectangular prism this net makes?

Nets of 3D Shapes · Grade 6 (Answer Key)

Look at each net, then answer the question.

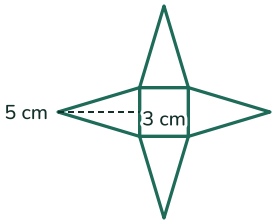

01 What is the surface area of the square pyramid this net makes? **39 cm²**

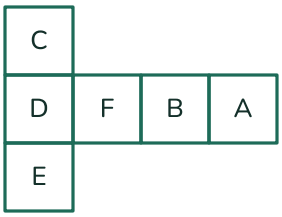

02 Fold this net into a cube. Which letter is opposite face E? **C**

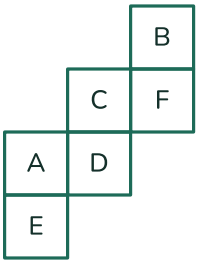

03 Fold this net into a cube. Which letter is opposite face C? **E**

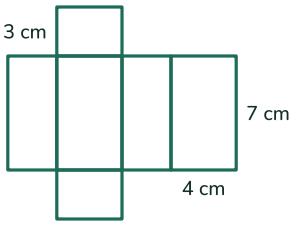

04 What is the surface area of the rectangular prism this net makes? **122 cm²**