Nets of 3D Shapes · Grade 6

Look at each net, then answer the question.

Name _____ Date _____ Score _____ / 4



01 Could this net be folded to make a cube? Yes or no. _____

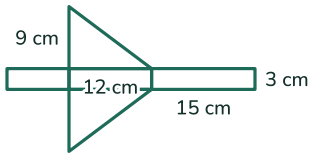

02 What is the surface area of the triangular prism this net makes? _____

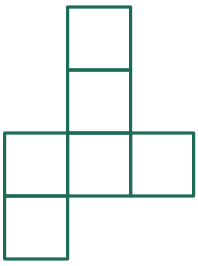

03 Does this net fold into a cube? Answer yes or no. _____

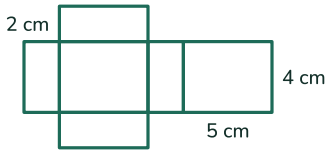

04 What is the surface area of the rectangular prism this net makes? _____

Nets of 3D Shapes · Grade 6 (Answer Key)

Look at each net, then answer the question.



01 Could this net be folded to make a cube? Yes or no? **no**

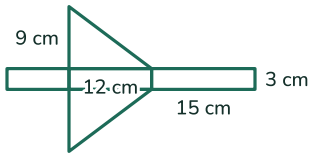

02 What is the surface area of the triangular prism this net makes? **216 cm²**

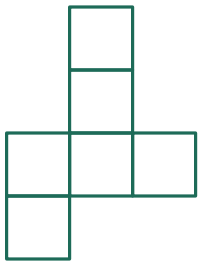

03 Does this net fold into a cube? Answer yes or no. **yes**

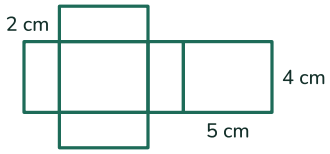

04 What is the surface area of the rectangular prism this net makes? **76 cm²**