Nets of 3D Shapes · Grade 6

Look at each net, then answer the question.

Name _____ Date _____ Score _____ / 4

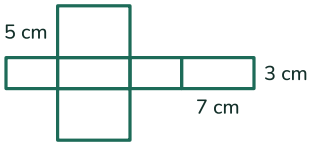

01 What is the surface area of the rectangular prism this net makes? _____

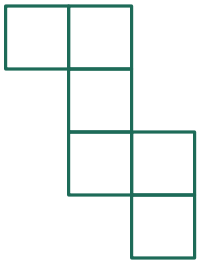

02 Which solid does this net fold into? _____



03 Each square of this net is 2 cm by 2 cm. What is the surface area of the cube? _____

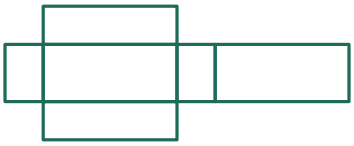

04 Fold this net up. What solid does it make? _____

Nets of 3D Shapes · Grade 6 (Answer Key)

Look at each net, then answer the question.

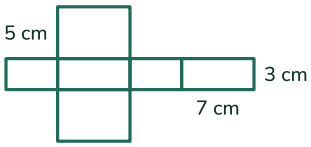

01 What is the surface area of the rectangular prism this net makes? **142 cm²**

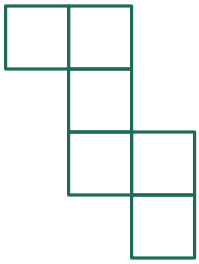

02 Which solid does this net fold into? **cube**



03 Each square of this net is 2 cm by 2 cm. What is the surface area of the cube? **24 cm²**

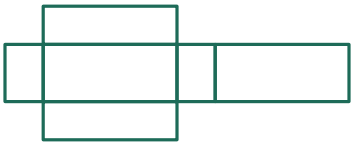

04 Fold this net up. What solid does it make?

rectangular prism