Data & Graphs · Grade 6

Name _____ Date _____ Score _____ / 6

01 Use the bar graph about laps run by each team. Look at where the vertical axis starts.

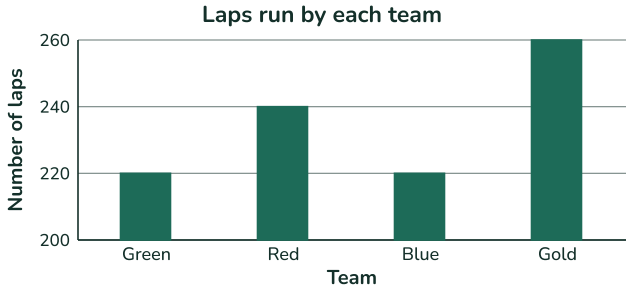

Source: run-a-thon record

a) What number does the vertical axis start at? _____

b) The Red bar looks how many times as tall as the Blue bar? _____

c) How many more laps did Red really have than Blue? _____

02 Use the histogram about daily steps counted by students.

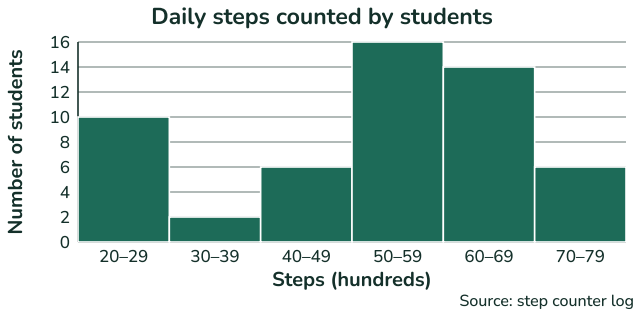

Source: step counter log

a) How many students counted 50 to 59 hundred steps? _____

b) How many students counted fewer than 70 hundred steps? _____

c) How many students are shown in all? _____

Data & Graphs · Grade 6 (Answer Key)

01 Use the bar graph about laps run by each team. Look at where the vertical axis starts.

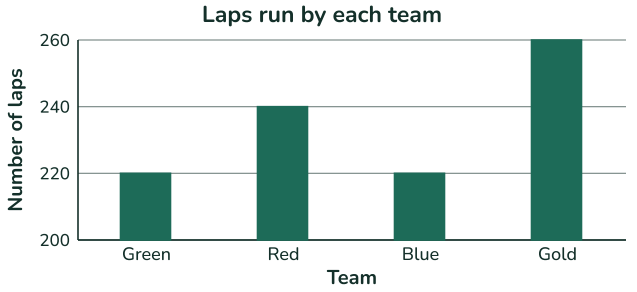

Source: run-a-thon record

a) What number does the vertical axis start at? **200**

b) The Red bar looks how many times as tall as the Blue bar? **2 times**

c) How many more laps did Red really have than Blue? **20 laps**

02 Use the histogram about daily steps counted by students.

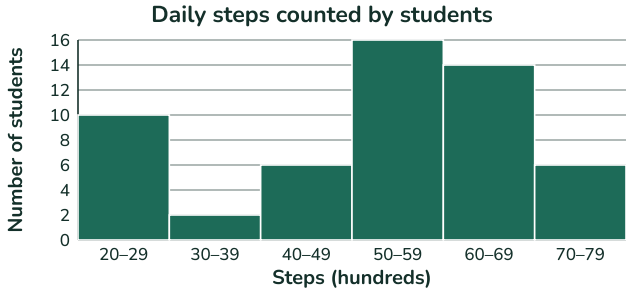

Source: step counter log

a) How many students counted 50 to 59 hundred steps? **16 students**

b) How many students counted fewer than 70 hundred steps? **48 students**

c) How many students are shown in all? **54 students**