Data & Graphs · Grade 6

Name _____ Date _____ Score _____ / 6

01 Use the line graph about laps jogged by the running club.

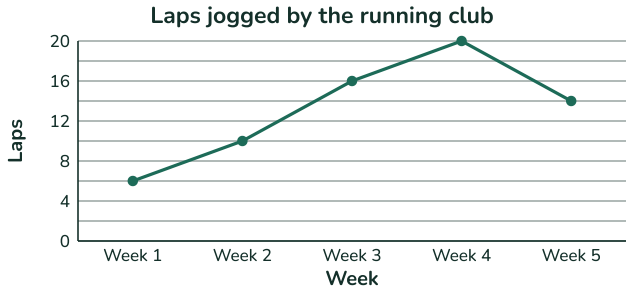

Source: club record

a) By how much did the number of laps increase from Week 2 to Week 4?

b) Between which two times did the number of laps increase the most?

c) Between which two times did the number of laps decrease the most?

02 Use the line graph about height of a bean plant.

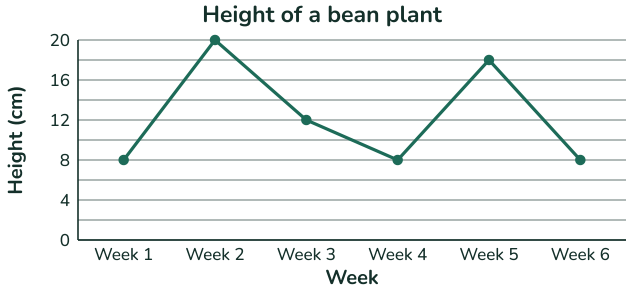

Source: science class log

a) By how much did the height decrease from Week 3 to Week 4?

b) Between which two times did the height increase the most?

c) Between which two times did the height decrease the most?

Data & Graphs · Grade 6 (Answer Key)

01 Use the line graph about laps jogged by the running club.

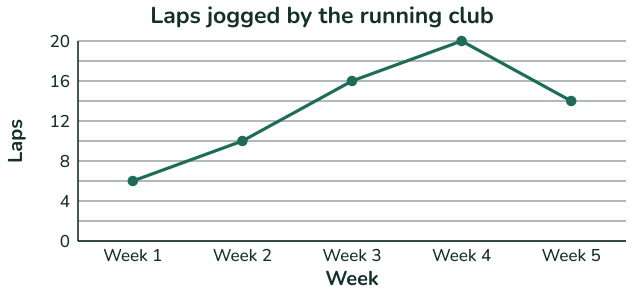

a) By how much did the number of laps increase from Week 2 to Week 4? **10 laps**

b) Between which two times did the number of laps increase the most? **Week 2 to Week 3**

c) Between which two times did the number of laps decrease the most? **Week 4 to Week 5**

02 Use the line graph about height of a bean plant.

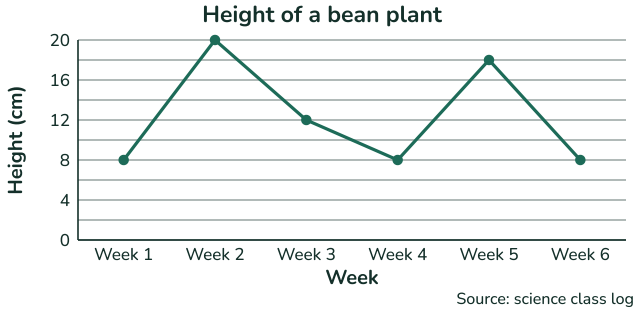

a) By how much did the height decrease from Week 3 to Week 4? **4 cm**

b) Between which two times did the height increase the most? **Week 1 to Week 2**

c) Between which two times did the height decrease the most? **Week 5 to Week 6**