Data & Graphs · Grade 6

Name _____ Date _____ Score _____ / 6

01 Use the bar graph about hot dogs sold at each game. Look at where the vertical axis starts.

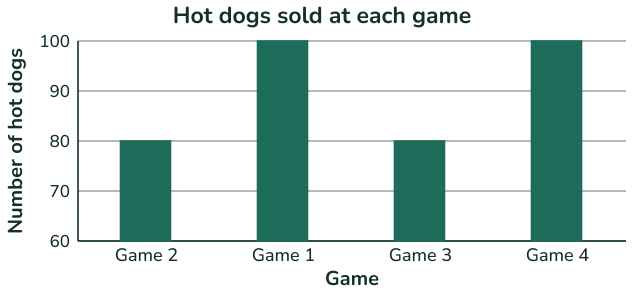

Source: snack bar record

a) What number does the vertical axis start at? _____

b) The Game 1 bar looks how many times as tall as the Game 2 bar? _____

c) How many more hot dogs did Game 1 really have than Game 2? _____

02 Use the line graph about height of a bean plant.

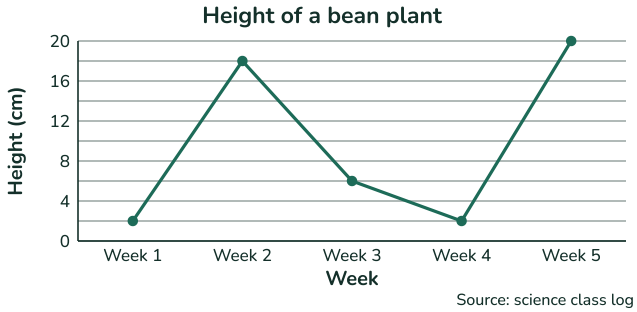

Source: science class log

a) What was the height in Week 5? _____

b) What was the height in Week 1? _____

c) When was the height the greatest? _____

Data & Graphs · Grade 6 (Answer Key)

01 Use the bar graph about hot dogs sold at each game. Look at where the vertical axis starts.

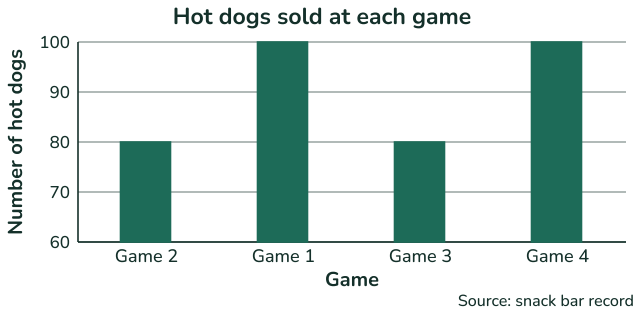

a) What number does the vertical axis start at? **60**

b) The Game 1 bar looks how many times as tall as the Game 2 bar? **2 times**

c) How many more hot dogs did Game 1 really have than Game 2? **20 hot dogs**

02 Use the line graph about height of a bean plant.

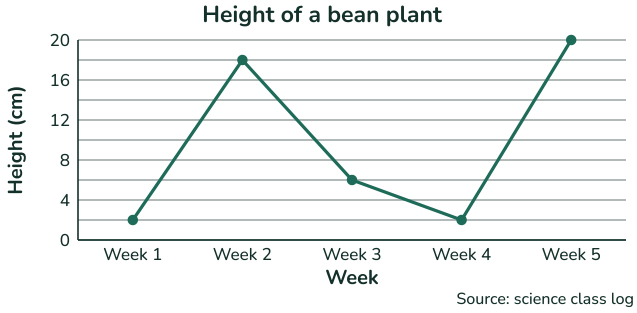

a) What was the height in Week 5? **20 cm**

b) What was the height in Week 1? **2 cm**

c) When was the height the greatest? **Week 5**