Nets of 3D Shapes · Grade 5

Look at each net, then answer the question.

Name _____ Date _____ Score _____ / 4

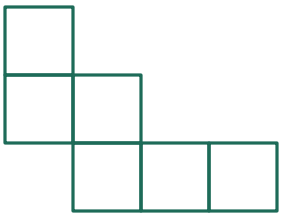

01 Will this net fold into a cube? Write yes or no. _____

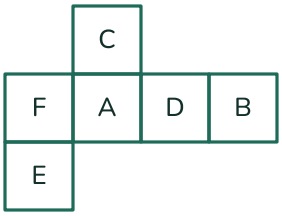

02 Fold this net into a cube. Which letter is opposite face C? _____

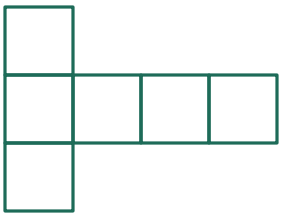

03 Each square of this net is 3 cm by 3 cm. What is the surface area of the cube? _____

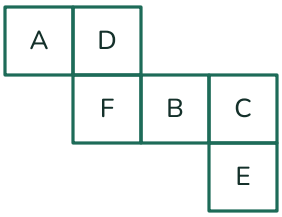

04 Fold this net into a cube. Which letter is opposite face B? _____

Nets of 3D Shapes · Grade 5 (Answer Key)

Look at each net, then answer the question.

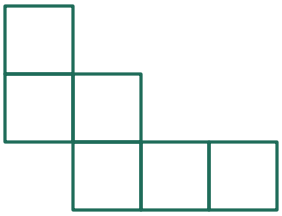

01 Will this net fold into a cube? Write yes or no. **no**

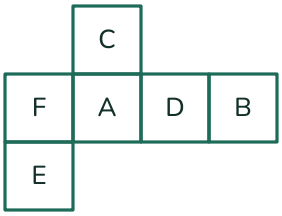

02 Fold this net into a cube. Which letter is opposite face C? **E**

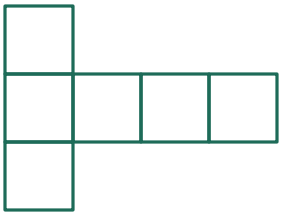

03 Each square of this net is 3 cm by 3 cm. What is the surface area of the cube? **54 cm²**

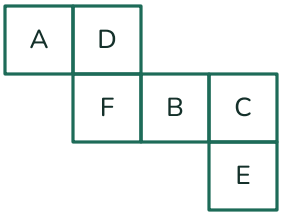

04 Fold this net into a cube. Which letter is opposite face B? **A**