Nets of 3D Shapes · Grade 5

Look at each net, then answer the question.

Name _____ Date _____ Score _____ / 4

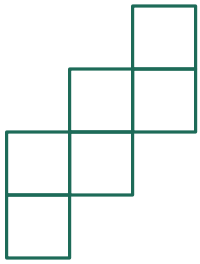

01 Which solid does this net fold into?

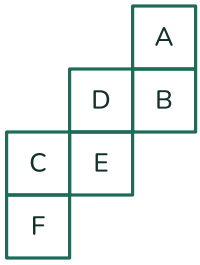

02 Fold this net into a cube. Which letter is opposite face D?

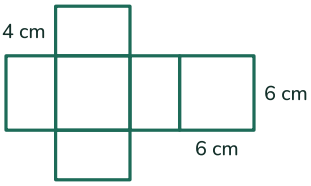

03 What is the surface area of the rectangular prism this net makes?

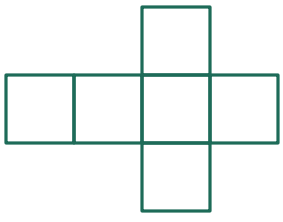

04 Each square of this net is 7 cm by 7 cm. What is the surface area of the cube?

Nets of 3D Shapes · Grade 5 (Answer Key)

Look at each net, then answer the question.

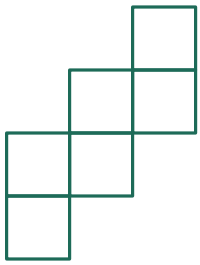

01 Which solid does this net fold into? **cube**

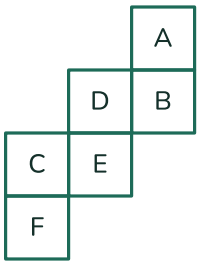

02 Fold this net into a cube. Which letter is opposite face D? **F**

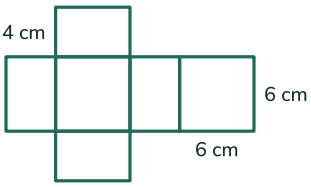

03 What is the surface area of the rectangular prism this net makes? **168 cm²**

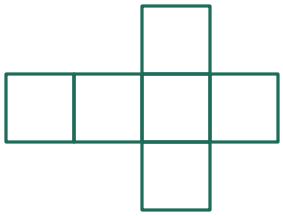

04 Each square of this net is 7 cm by 7 cm. What is the surface area of the cube? **294 cm²**