Nets of 3D Shapes · Grade 5

Look at each net, then answer the question.

Name _____ Date _____ Score _____ / 4

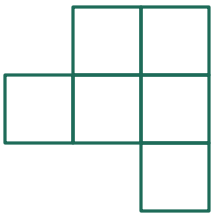

01 Could this net be folded to make a cube? Yes or no? _____

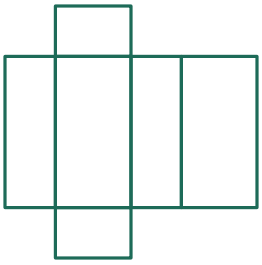

02 How many edges does the solid made from this net have? _____

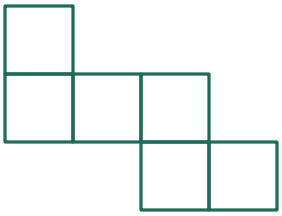

03 Fold this net up. What solid does it make? _____

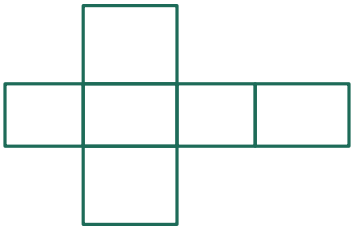

04 Name the solid this net makes. _____

Nets of 3D Shapes · Grade 5 (Answer Key)

Look at each net, then answer the question.

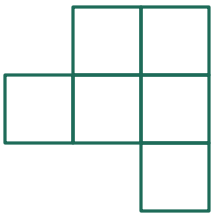

01 Could this net be folded to make a cube? Yes or no? **no**

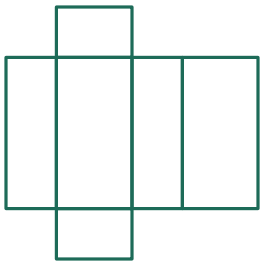

02 How many edges does the solid made from this net have? **12**

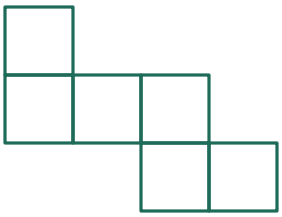

03 Fold this net up. What solid does it make? **cube**

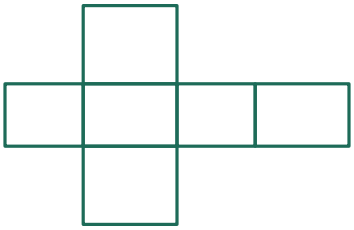

04 Name the solid this net makes.

rectangular prism