Data & Graphs · Grade 5

Name _____ Date _____ Score _____ / 6

01 Use the stacked bar graph about books sold at the book fair.

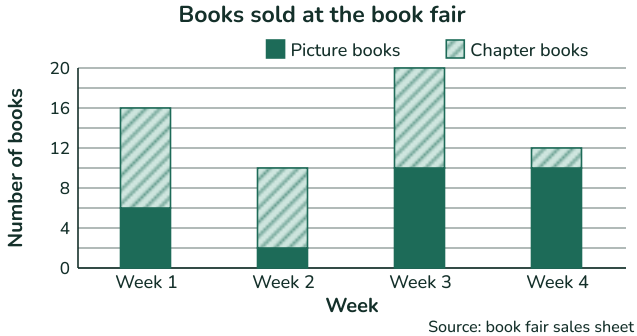

Source: book fair sales sheet

a) For Week 1, how many more books are in the "Chapter books" part than the "Picture books" part? _____

b) What is the total of the "Chapter books" parts for all the weeks? _____

c) How many more books were there for Week 3 than for Week 1? _____

02 Use the bar graph about raffle tickets sold by each club. Look at where the vertical axis starts.

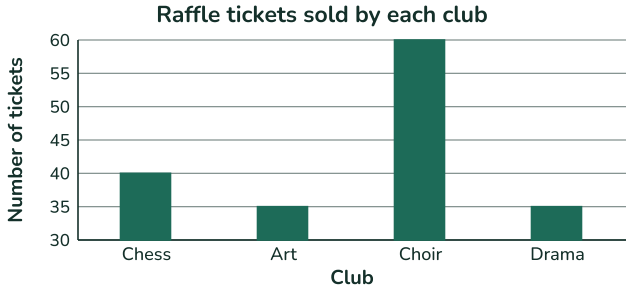

Source: fundraiser record

a) What number does the vertical axis start at? _____

b) The Chess bar looks how many times as tall as the Drama bar? _____

c) How many more tickets did Chess really have than Drama? _____

Data & Graphs · Grade 5 (Answer Key)

01 Use the stacked bar graph about books sold at the book fair.



a) For Week 1, how many more books are in the “Chapter books” part than the “Picture books” part? **4**

b) What is the total of the “Chapter books” parts for all the weeks? **30**

c) How many more books were there for Week 3 than for Week 1? **4**

02 Use the bar graph about raffle tickets sold by each club. Look at where the vertical axis starts.

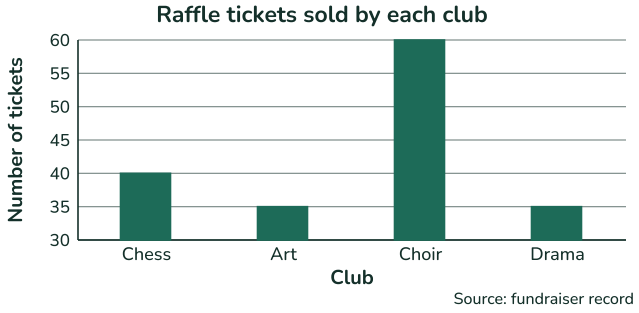

a) What number does the vertical axis start at? **30**

b) The Chess bar looks how many times as tall as the Drama bar? **2 times**

c) How many more tickets did Chess really have than Drama? **5 tickets**