Data & Graphs · Grade 5

Name _____ Date _____ Score _____ / 6

01 Use the stacked bar graph about bottles recycled by each class.



Source: recycling bin count

a) For Room 3, how many bottles are in the “Glass” part of the bar?

b) For Room 3, how many bottles are in the “Plastic” part of the bar?

c) What is the total number of bottles for Room 3?

02 Use the stacked bar graph about items collected for the food drive.

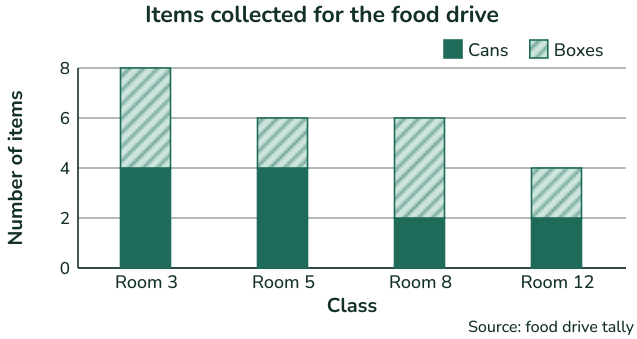

Source: food drive tally

a) For Room 5, how many items are in the “Cans” part of the bar?

b) For Room 8, how many items are in the “Boxes” part of the bar?

c) What is the total number of items for Room 3?

Data & Graphs · Grade 5 (Answer Key)

01 Use the stacked bar graph about bottles recycled by each class.



a) For Room 3, how many bottles are in the “Glass” part of the bar? **6**

b) For Room 3, how many bottles are in the “Plastic” part of the bar? **2**

c) What is the total number of bottles for Room 3? **8**

02 Use the stacked bar graph about items collected for the food drive.

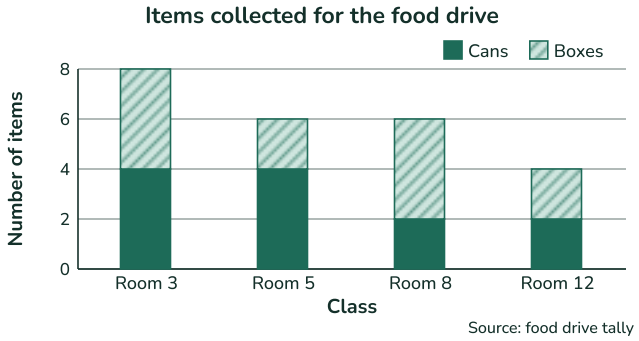

a) For Room 5, how many items are in the “Cans” part of the bar? **4**

b) For Room 8, how many items are in the “Boxes” part of the bar? **4**

c) What is the total number of items for Room 3? **8**