Nets of 3D Shapes · Grade 4

Look at each net, then answer the question.

Name _____ Date _____ Score _____ / 4

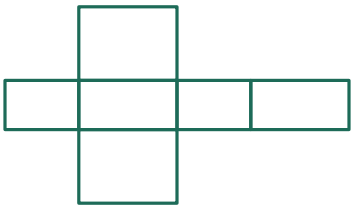

01 Which solid does this net fold into?

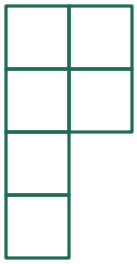

02 Does this net fold into a cube? Answer yes or no.

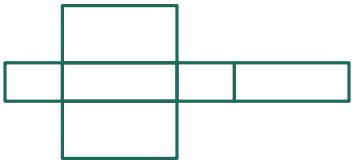

03 How many faces does the solid made from this net have?

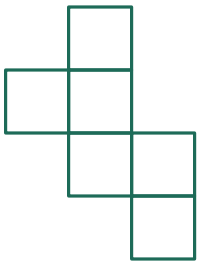

04 Which solid does this net fold into?

Nets of 3D Shapes · Grade 4 (Answer Key)

Look at each net, then answer the question.

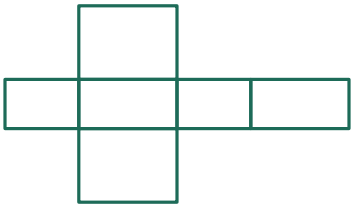

01 Which solid does this net fold into?

rectangular prism

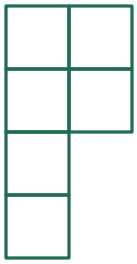

02 Does this net fold into a cube? **no**
Answer yes or no.

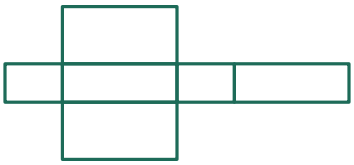

03 How many faces does the solid made from this net have? **6**

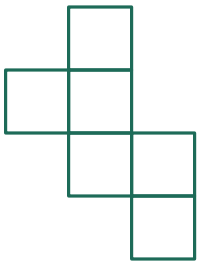

04 Which solid does this net fold into? **cube**