Nets of 3D Shapes · Grade 4

Look at each net, then answer the question.

Name _____ Date _____ Score _____ / 4

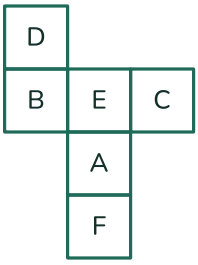

01 Fold this net into a cube. Which letter is opposite face D?

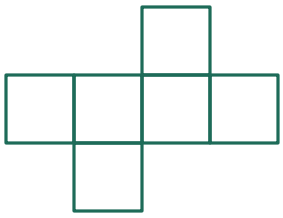

02 Does this net fold into a cube? Answer yes or no.

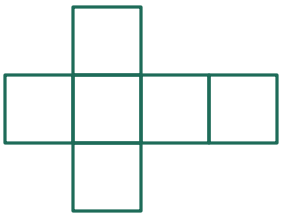

03 How many edges does the solid made from this net have?



04 Which solid does this net fold into?

Nets of 3D Shapes · Grade 4 (Answer Key)

Look at each net, then answer the question.

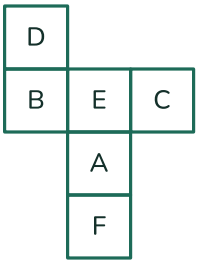

01 Fold this net into a cube. Which letter is opposite face D?

A

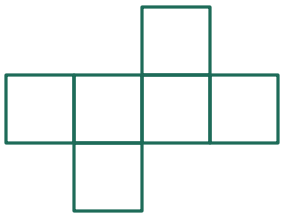

02 Does this net fold into a cube? Answer yes or no.

yes

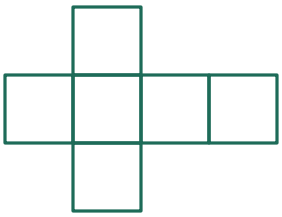

03 How many edges does the solid made from this net have?

12



04 Which solid does this net fold into?

square pyramid