Nets of 3D Shapes · Grade 4

Look at each net, then answer the question.

Name _____ Date _____ Score _____ / 4

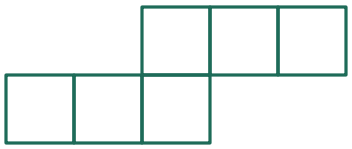

01 Which solid does this net fold into?

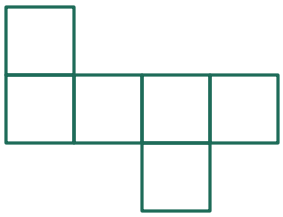

02 Will this net fold into a cube? Write yes or no.

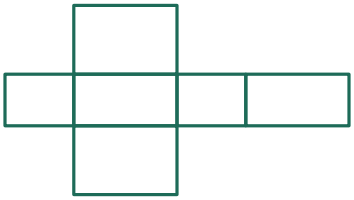

03 Name the solid this net makes.

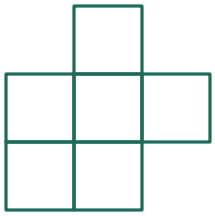

04 Will this net fold into a cube? Write yes or no.

Nets of 3D Shapes · Grade 4 (Answer Key)

Look at each net, then answer the question.

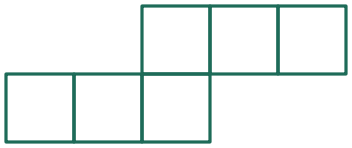

01 Which solid does this net fold into? **cube**

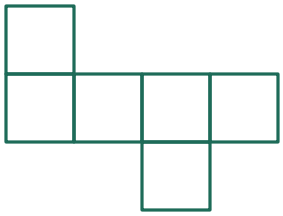

02 Will this net fold into a cube? Write yes or no. **yes**

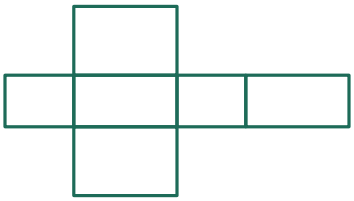

03 Name the solid this net makes.

rectangular prism

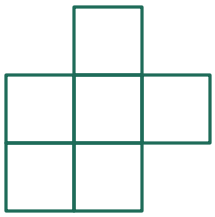

04 Will this net fold into a cube? Write yes or no. **no**