FRACTIONS · GRADE 3

Fractions · Grade 3

Look at each picture or number line, then answer the question.

Name _____ Date _____ Score _____ / 4

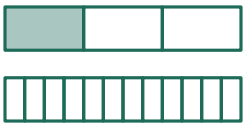

01 $\frac{1}{3} = \frac{?}{12}$ _____



02 What fraction does the dot show? _____

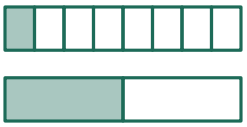

03 Which fraction is less: $\frac{1}{8}$ or $\frac{1}{2}$? _____



04 What fraction of this shape is shaded? _____

Fractions · Grade 3 (Answer Key)

Look at each picture or number line, then answer the question.

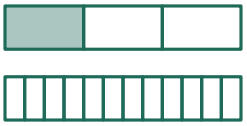

01 $\frac{1}{3} = \frac{?}{12}$ **4**



02 What fraction does the dot show? $\frac{1}{6}$

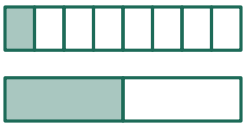

03 Which fraction is less: $\frac{1}{8}$ or $\frac{1}{2}$? $\frac{1}{8}$



04 What fraction of this shape is shaded? $\frac{3}{4}$