FRACTIONS · GRADE 2

Fractions · Grade 2

Look at each picture or number line, then answer the question.

Name _____ Date _____ Score _____ / 4



01 What fraction of this shape is shaded? _____

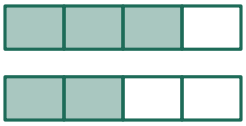

02 Which fraction is greater: $\frac{3}{4}$ or $\frac{2}{4}$? _____



03 What fraction of the squares are shaded? _____



04 Is half of the shape shaded? _____

FRACTIONS · GRADE 2

Fractions · Grade 2 (Answer Key)

Look at each picture or number line, then answer the question.



01 What fraction of this shape is shaded? $\frac{1}{4}$

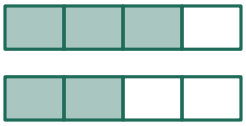

02 Which fraction is greater: $\frac{3}{4}$ or $\frac{2}{4}$? $\frac{3}{4}$



03 What fraction of the squares are shaded? $\frac{1}{6}$



04 Is half of the shape shaded? **no**