Fractions · Grade 2

Look at each picture or number line, then answer the question.

Name _____ Date _____ Score _____ / 4



01 How many $\frac{1}{4}$ pieces make one whole? _____

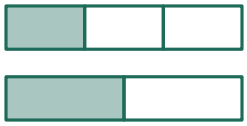

02 Which fraction is greater: $\frac{1}{3}$ or $\frac{1}{2}$? _____



03 What fraction of the shape is shaded? _____



04 What fraction of the circles are shaded? _____

FRACTIONS · GRADE 2

Fractions · Grade 2 (Answer Key)

Look at each picture or number line, then answer the question.



01 How many $\frac{1}{4}$ pieces make one whole? **4**

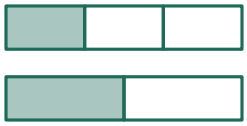

02 Which fraction is greater: $\frac{1}{3}$ or $\frac{1}{2}$? $\frac{1}{2}$



03 What fraction of the shape is shaded? $\frac{1}{3}$



04 What fraction of the circles are shaded? $\frac{3}{8}$