Fractions · Grade 1

Look at each picture or number line, then answer the question.

Name _____ Date _____ Score _____ / 4



01 Is half of the shape shaded? _____



02 Are all the parts the same size? _____



03 What fraction of the shape is shaded? _____



04 How many equal parts is the shape split into? _____

FRACTIONS · GRADE 1

Fractions · Grade 1 (Answer Key)

Look at each picture or number line, then answer the question.



01 Is half of the shape shaded? **no**



02 Are all the parts the same size? **no**



03 What fraction of the shape is shaded? $\frac{1}{2}$

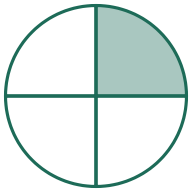

04 How many equal parts is the shape split into? **4**